一〇九學年度第二學期數學第二冊第一單元評量試題

_____國小 _____年_____班 座號_____ 姓名_____

一、數一數，共有多少？ 每題 5 分，共 20 分

(1)



(40) 隻

(2)



(54) 顆

(3)



(32) 個

(4)

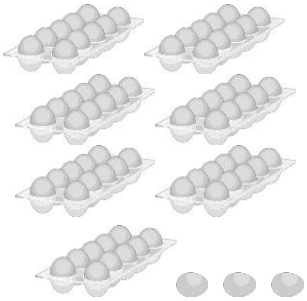

(73) 個

二、填入適當的數： 每格 2 分，共 32 分

(1) 45 — 46 — 47 — 48 — 49

(2) 30 — 35 — 40 — 45 — 50

(3) 28 — 30 — 32 — 34 — 36

(4) 38 — 37 — 36 — 35 — 34

(5) 76 — 77 — 78 — 79 — 80

(6) 55 — 60 — 65 — 70 — 75

(7) 50 — 60 — 70 — 80 — 90

(8) 91 — 90 — 89 — 88 — 87

三、比一比，比較大的數在（ ）裡打✓ ： 每題 2 分，共 8 分

(1)



(✓) ( )

(2)



(✓) ( )

(3)



(✓) ( )

(4)



( ) (✓)

五、小玲和小琪玩猜拳遊戲，贏的前進 1 格， 輸的退後 1 格。看圖回答問題：每格 5 分，共 20 分

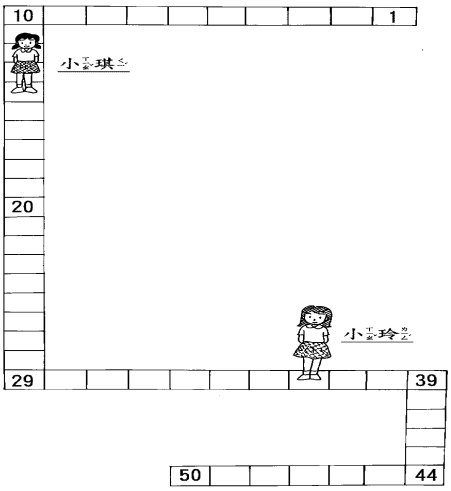

(1)小玲現在踏在第（ 36 ）格。

(2)小琪現在踏在第（ 14 ）格。

(3)猜拳一次，如果小琪猜輸，應該踏在第（ 13 ）格，小玲應該踏在第（ 37 ）格。